Chapter 8 Assignment 4

Name _____

Period _____

axes denoted by •

1.

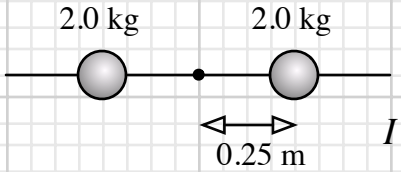

I = _____

2.

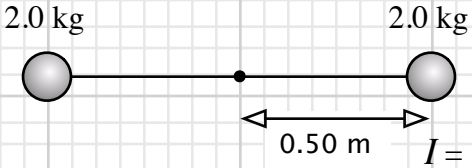

I = _____

3.

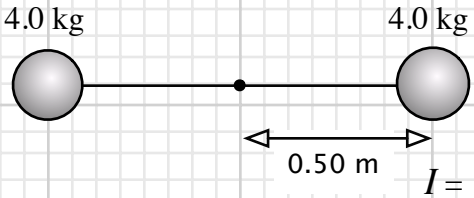

I = _____

4.

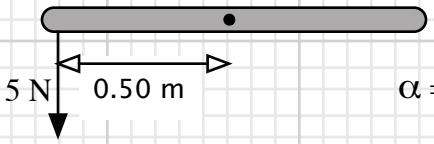

m = 3.0 kg

α = _____

5.

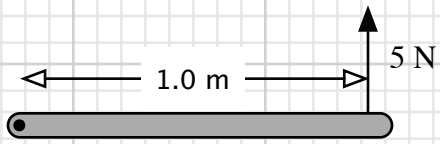

m = 3.0 kg

α = _____

6.

m = 0.5 kg

r = 0.15 m

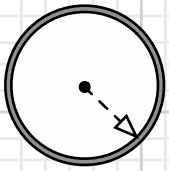

I = _____

7.

m = 0.5 kg

r = 0.15 m

I = _____

8.

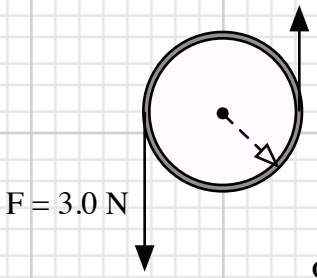

m = 0.5 kg

r = 0.15 m

α = _____

9.

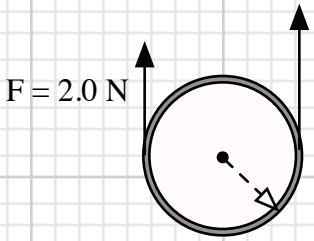

F = 3.0 N

m = 0.5 kg

r = 0.15 m

α = _____

10.

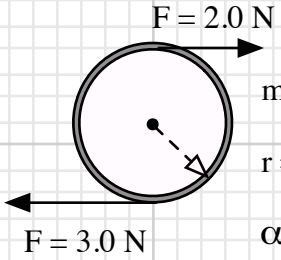

m = 0.5 kg

r = 0.15 m

α = _____

11.

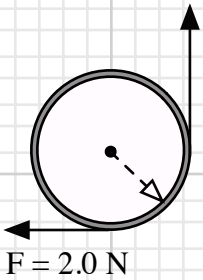

F = 3.0 N

m = 0.5 kg

r = 0.15 m

α = _____